Šípkami po snehu

Začni na označenom políčku. Každá šípka znamená jeden krok. Zapíš súradnice cieľového políčka.

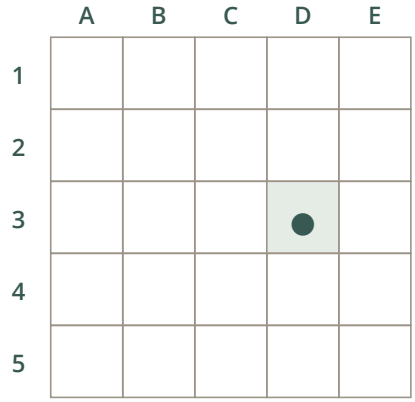

→ ↑ ↓ ←

= _____

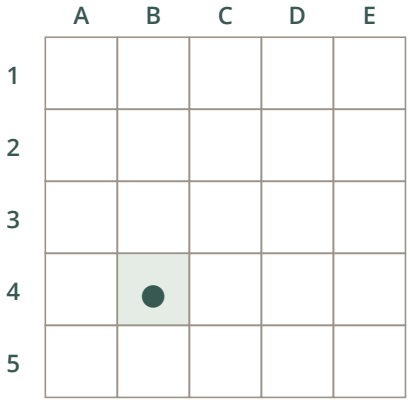

↓ ← → ← ↑

= _____

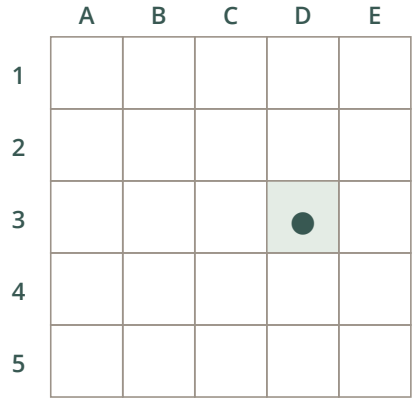

↓ ↓ ↑ ← ← ←

= _____

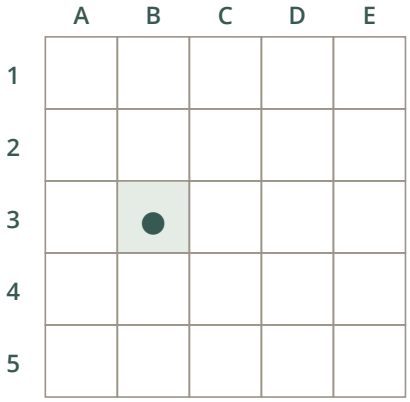

↑ ← → ← ↓ → →

= _____

Šípkami po snehu

Začni na označenom políčku. Každá šípka znamená jeden krok. Zapíš súradnice cieľového políčka.

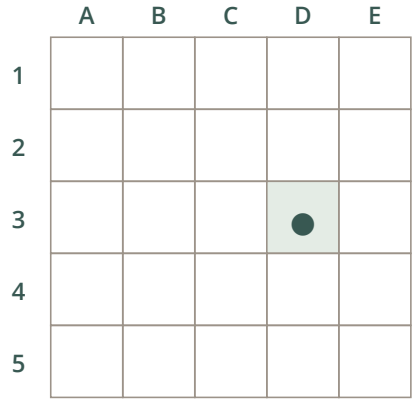

→ ↑ ↓ ←

= D3

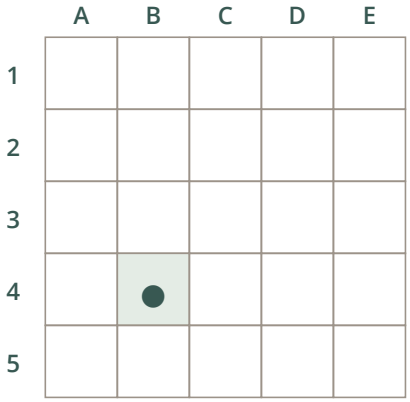

↓ ← → ← ↑

= A4

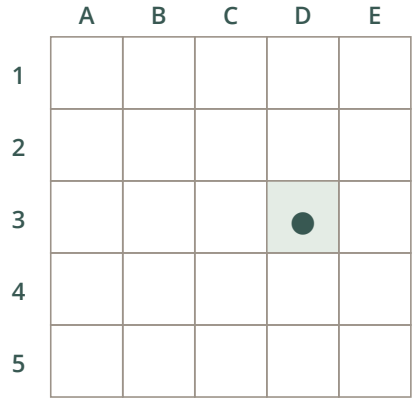

↓ ↓ ↑ ← ← ←

= A4

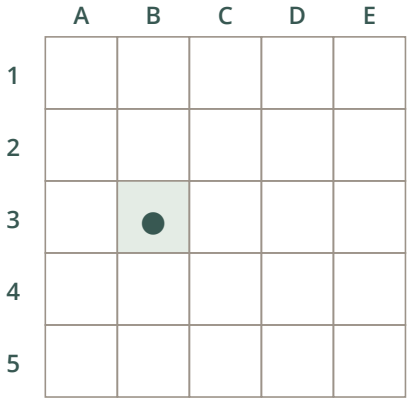

↑ ← → ← ↓ → →

= C3